3RD GRADE SUMMER PACKET

Thank you in advance for your support and encouragement as your child continues to develop his/her academic skills. With your help, your child will surely return to school in August ready to succeed! I understand this is due back the first full day of school.

♡ Third Grade Teachers

Student Name: _____

I have checked the completed work_____.
Parent Signature

3RD GRADE SUMMER PACKET

Thank you in advance for your support and encouragement as your child continues to develop his/her academic skills. With your help, your child will surely return to school in August ready to succeed! I understand this is due back the first full day of school.

♡ Third Grade Teachers

Student Name: _____

I have checked the completed work_____.
Parent Signature

Rising 3rd Grade Summer Assignments

Dear Parents,

Soon your child will be enjoying his/her 3rd grade year! Summer is a time for rest, rejuvenation, and fun.

While we encourage this time of relaxation, it is also a time for keeping our Reading, Math, and English skills fresh. Research indicates that at least one month of learning loss can take place over the summer. To protect your child's academic growth, you will find the required practice for some of the academic skills that will be learned this year. We recommend that you create a routine for summer review. We want this time to be well paced and meaningful. This will ensure that your child is confident and prepared as he/she returns to school in August.

The following assignments will be **due ON the first full day of school**. Ten points will be deducted from any late assignments. The reading assignments will count as a Reading grade, the writing assignment will count as an English grade, and the math assignments will count as a Math grade. (This will be your child's first grade for the year.)

Reading

- Assignment 1: Pick 1 fiction chapter book and complete the 'my book report' sheet. (Attached are chapter book suggestions, but you may pick a book not on the list.)
- Assignment 2: Pick 1 nonfiction book (does not have to be a chapter) of your choice and complete the '5 interesting facts' sheet.
    - Students will be able to AR tests on both books once we are back in school.
    - Books need to be 3.0 or higher reading level. You can use www.arbookfind.com to check the level.

English

- Assignment 1: On the provided paper, write about 2 adventures you went on this summer. Each entry should be written on a new sheet with an illustration drawn.
    - Each entry should have correct punctuation, capitalization, and spelling.
    - At least 4 sentences written.
    - Writing should be legible and use appropriate spacing.

Math

- Assignment 1: Complete the math prerequisite skills packet & facts practice sheet.

- Practice Math Facts! Students are required to have already mastered ALL addition and subtraction facts up to 20. Shortly after the year begins, students will start learning their multiplication facts and taking timed tests on each fact.
    - Flash cards are the best way to practice. However, there are also numerous websites/apps that have practice games.

  www.muliplication.com
  www.mathplayground.com



SUMMER READING



This book list is designed to give rising 3rd graders ideas for summer reading. Please choose 1 fiction chapter book from the list below **OR** 1 fiction chapter book of your choice. Remember each book read needs to be a level of 3.0 or higher.

www.arbookfind.com

- **Beverly Cleary**
  - *The Growing-Up Feet* (3.0)
  - *Henry and Ribsy* (4.6)
  - *Henry Huggins* (4.7)
  - *Runway Ralph* (5.3)
- **Patricia Polacco**
  - *Mrs. Katz and Tush* (3.1)
  - *My Rotten Redheaded Older Brother* (3.3)
  - *Thunder Cake* (3.5)
  - *My Ol' Man* (3.7)
  - *Chicken Sunday* (3.7)
  - *Pink and Say* (3.8)
  - *Just Plain Fancy* (3.9)
  - *Thank you, Mr. Falker* (4.1)
- **Judy Blume**
  - *The Pain and the Great* (3.1)
  - *Fudge-a-Mania* (3.3)
  - *Tales of a Fourth Grade Nothing* (3.3)
  - *Superfudge* (3.4)
  - *Otherwise Known as Shelia the Great* (3.5)
  - *Double Fudge* (3.6)
- **Kate DiCamillo**
  - *Mercy Watson: Something Wonky This Way Comes* (3.2)
  - Where Are You Going, Baby Lincoln? (3.7)
  - *Because of Winn Dixie* (3.9)
  - *The Tiger Rising* (4.0)
  - *Flora & Ulysses: The Illuminated Adventures* (4.3)
- **Mike Thaler**
  - *The Class from the Black Lagoon* (3.5)
  - *The Field Day from the Black Lagoon* (3.6)
  - Hubie Cook: Super Spy (3.6)
  - *The Science Fair from the Black Lagoon* (3.8)
- **Dan Gutman**
  - *Ms. Hannah is Bananas!* (3.6)
  - *Mrs. Roopy is Loppy* (3.9)
  - *Satch & Me: A Baseball Card Adventure* (4.1)
  - *Miss Daisy is Crazy* (4.3)
  - *They Came from Center Field* (4.4)
- **Patricia MacLachan-**
  - *Grandfather's Dance* (3.1)
  - *The Boxcar Children Beginning* (3.1)
  - *Through Grandpa's Eyes* (3.2)
  - *Skylark* (3.2)
  - *Painting The Wind* (3.4)
  - *Sara, Plain and Tall* (3.4)
  - *Prairie Days* (3.6)
- **David A. Miller**
  - *Cam Jansen and the Mystery of the UFO* (3.4)
  - *Cam Jansen and the Ghostly Mystery* (3.4)
  - *Cam Jansen and the Chocolate Fudge Mystery* (3.7)
  - *Cam Jansen and the Mystery of the Dinosaur Bones* (3.8)
  - *Cam Jansen and the Mystery of the Circus Clown* (3.9)
- **Cynthia Rylant**
  - *When I Was Young in the Mountains* (3.6)
  - *The Relatives Came* (4.1)
  - *Gooseberry Park* (4.4)
  - any book in the *The Lighthouse Family* series
- **Gertrude Warner**
  - any book in the *Boxcar* series
- **Patricia Reilly Giff**
  - any book in the *Rosie* series
- **Ellen Miles**
  - any book in the *Puppy Place* series
- **Sara Pennypacker**
  - any book in the *Clementine* series
- **Ann M. Martin**
  - any book in the *Babysitters Club* series
- John Peterson
  - any book in *The Littles* series
- Any book in the *American Girl* series

My Book Report

Name: _____ Date: _____

Title of Book:

_____

Author:

_____

Illustrator:

_____

Setting of the Story

Main Characters

1. _____

_____

2. _____

_____

3. _____

_____

Summary of the Story

Moral of the Story

The Ending of the Story

This book was...

- awesome
- pretty good
- okay
- not my favourite

© Simple Living Creative Learning

Name: _____

Title: _____

Author: _____

Nonfiction Book: 5 Interesting Facts!

1. _____
_____
_____

2. _____
_____
_____

3. _____
_____
_____

4. _____
_____
_____

5. _____
_____
_____



Name _____



Name _____

Name _____

Write the correct answer.

1. How many tens and ones are equal to 43 ones?

   _____ tens _____ ones

2. How many hundreds and tens are equal to 37 tens?

   _____ hundreds _____ tens

3. How many tens are equal to 6 hundreds 8 tens?

   _____ tens

4. Jen is solving a subtraction problem. What addition fact can help her solve the subtraction fact $14 - 8 = \blacksquare$?

   _____

5. Eli has 5 action figures. He gets 2 more action figures for his birthday. How many action figures does he have now?

   _____

6. Rachel had 13 pencils. She gave 5 pencils away. How many pencils does Rachel have now?

   _____

7. Skip count by fives. Write the missing numbers.

   25, 30, _____, 40, 45, _____

   _____

8. Read the clock. Write the time.



   _____

GO ON

© Houghton Mifflin Harcourt Publishing Company

Name _____

9. Lucas has some coins in his pocket.



   How much money does Lucas have?

   _____

10. Write the number word and number.



   _____

11. Skip count by twos. Write the missing numbers.

   8, 10, 12, _____, _____, 18, 20

   _____

12. Ms. Thompson graded 8 tests before lunch and 7 tests after lunch. How many tests did Ms. Thompson grade in all?

   _____

13. Mr. Reaves has some oranges.



   Skip count. Write how many in all.

   _____

14. Skip count. Write the missing numbers.

   10, 15, _____, _____, 30, 35

   _____

15. Thea set out plates of cookies for a bake sale.



   How many cookies did Thea set out in all?

   _____

16. Ming has 4 vases of flowers with 2 flowers in each vase. How many flowers does Ming have in all?

   _____

GO ON

© Houghton Mifflin Harcourt Publishing Company

Name _____

17. Use the array.



2 rows of 3

What multiplication sentence can be used to represent the array?

_____

18. A youth basketball league has 4 teams. Each team has 10 players. How many players does the league have in all?

_____

19. Ty wants to separate these blocks into groups of 2.



How many equal groups of 2 can Ty make?

_____

20. Look at the picture.

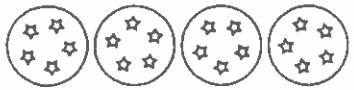

How many groups are there in the picture? How many stars are in each group?

_____

21. A baseball game is 9 innings long. If Cal plays 8 games in a season, how many innings will he play?

_____

22. Nuveen divided 8 soccer balls into 4 equal groups.

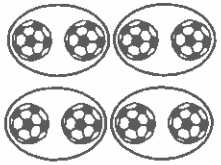

How many soccer balls are in each group?

_____

23. Val wrote this multiplication number sentence.

$54 = ____ \times 9$

What is the missing factor?

_____

24. Chairs are being set up in the library for a play. There are 8 rows of chairs, with 7 chairs in each row. How many chairs are there in all?

_____

GO ON

© Houghton Mifflin Harcourt Publishing Company

Name _____

25. Kelsey drew these two shapes.



Circle the shape that has equal parts.

26. Write the number of shaded parts and the number of equal parts.



_____

_____

27. Dan has some pencils.



Write the number of pencils that are white and the number in the whole group.

_____

_____

28. Circle the shape that has $\frac{1}{2}$ shaded.



29. Circle the shape that has $\frac{1}{4}$ shaded.

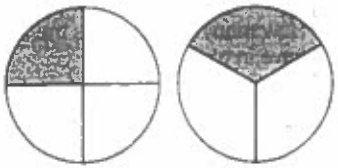

30. Molly drew this picture.

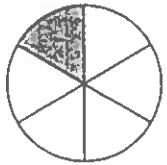

Write the fraction that names the shaded part of Molly's picture.

_____

GO ON

© Houghton Mifflin Harcourt Publishing Company

Name _____

31. Write the fraction that names the shaded part of the group.



_____

32. Matt colored some shapes.



What shapes did Matt color?

_____

33. Jose drew this shape.



How many sides does the shape have?

_____

34. Circle the shapes that have 5 or more sides.



35. Ms. Bradley bought a can of soup at the grocery store.



What solid shape is the can?

_____

GO ON

© Houghton Mifflin Harcourt Publishing Company

Name _____

36. Wes is using triangle pattern blocks to cover this shape.

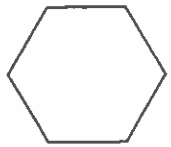

How many triangle pattern blocks will he need to cover the shape?

_____

37. Lonnie is making a bracelet by stringing beads in a pattern.



What is the pattern unit?

_____

38. Greg measured a piece of string with paper clips.



About how long is the piece of string?

_____

39. Emily measured the key to her front door.



About how long is the key?

_____

40. Matt bought 4 pencils, 2 erasers, and 3 notebooks. How many items did he buy altogether?

_____

STOP

© Houghton Mifflin Harcourt Publishing Company

NAME:.....

Addition & Subtraction Facts

1) 18 + 11 = ...	2) 20 + 10 = ...	3) 3 + 6 = ...	4) 12 + 18 = ...	5) 6 + 6 = ...	6) 1 + 12 = ...
7) 2 + 1 = ...	8) 10 + 9 = ...	9) 10 + 4 = ...	10) 11 + 12 = ...	11) 8 + 0 = ...	12) 9 + 19 = ...
13) 7 + 4 = ...	14) 11 + 4 = ...	15) 5 + 6 = ...	16) 15 + 7 = ...	17) 7 + 18 = ...	18) 12 + 1 = ...
19) 16 + 15 = ...	20) 4 + 13 = ...	21) 0 + 11 = ...	22) 2 + 5 = ...	23) 9 + 12 = ...	24) 3 + 18 = ...
25) 9 - 6 = ...	26) 14 - 1 = ...	27) 20 - 2 = ...	28) 10 - 10 = ...	29) 10 - 10 = ...	30) 16 - 5 = ...
31) 20 - 4 = ...	32) 7 - 1 = ...	33) 12 - 0 = ...	34) 5 - 2 = ...	35) 8 - 2 = ...	36) 16 - 9 = ...
37) 6 - 1 = ...	38) 17 - 4 = ...	39) 7 - 2 = ...	40) 8 - 2 = ...	41) 20 - 14 = ...	42) 17 - 1 = ...
43) 2 - 1 = ...	44) 19 - 1 = ...	45) 11 - 10 = ...	46) 17 - 10 = ...	47) 18 - 12 = ...	48) 5 - 5 = ...