Davidson Fine Arts Magnet School
AP Human Geography Summer Assignment
School Year 26-27

AP Human Geography is not a traditional geography class. Instead of learning about the locations of physical and political features, this course focuses on the interactions between humans and their environment and between human populations. As a prerequisite for this course (your summer assignment), AP Human Geography students are expected to enter class with a basic understanding of the physical and political geography of the world. As well as, a base knowledge of the first unit's terms that we will be studying in class. There are seven units in AP Human Geography, and you will be tasked with completing Unit 1 terms before school begins.

To ensure that students are adequately prepared for geographic requirements, students are tasked with their summer assignment for AP Human Geography, with being able to identify the locations of a series of physical and political arrangements in our world and defining Unit 1 terms. Task: Students are to identify, review, study, and memorize the locations of the political and physical arrangements provided on the lists to follow. Students are to define or describe the following list of Unit 1 terms. Students will be assessed on this information within the first few weeks of school. Tips: DO NOT PROCRASTINATE – you have the entire summer to do this, do a little at a time. This is not an assignment that can be completed at 2AM the night before. Students should download and complete the required identifications on the various maps provided. Students should use Quizlet or other methods for defining the attached list. When searching for definitions for AP Human Geography, it is extremely important that students indicate in their search that they want the AP Human Geography definition. For example, you would type into Google, "What is the definition of _____ in AP Human Geography". Often times this will result in a Quizlet (these are a great resource to use).

Students should utilize the many resources the internet provides for map memorization and Unit 1 terms. Again, students will be assessed on this information within the first few weeks of school. Each student MUST attain at least the minimum passing score of 85%. Students who score below a 85% will be required to retake the exam until the minimum standard is achieved. Enjoy your summer and I look forward to meeting all of you at the start of the new school year.

DUE: FIRST DAY OF SCHOOL 🙂

Aloha, Ms. Thompson
thompka@boe.richmond.k12.ga.us

AP Human Geography Summer Map Packet Instruction Sheet

DIRECTIONS: Find and label the political entities and physical features listed below. Please, only use the maps provided for this assignment. Be sure to mark items on the appropriate map, as indicated. Use the colors and symbols described at the end of this packet. DO NOT place letters or numbers on your map. If you cannot fit a name on your map, draw lines and write the name out to the side. All labels should be NEAT and horizontal. Pace yourself so that you have plenty of time to complete this assignment AND to enjoy your summer!

A. North America: Complete the following steps on the North America map.

- **a. Label each of the territories of Canada:**
  - **i. New Brunswick**
  - **ii. Prince Edward Island**
  - **iii. Nova Scotia**
  - **iv. Newfoundland and Labrador**
  - **v. Quebec**
  - **vi. Ontario**
  - **vii. Manitoba**
  - **viii. Saskatchewan**
  - **ix. Alberta**
  - **x. British Columbia**
  - **xi. Yukon Territory**
  - **xii. Northwest Territories**
  - **xiii. Nunavut**
- **b. Label the United States**
- **c. Label the following major cities**
  - **i. Washington D.C.**
  - **ii. Ottawa**
  - **iii. New York City**
  - **iv. Chicago**
  - **v. Toronto**
- **d. Label and color the following physical features:**
  - **i. Rocky Mountains**
  - **ii. Lake Superior**
  - **iii. Lake Michigan**
  - **iv. Lake Huron**
  - **v. Lake Erie**
  - **vi. Lake Ontario**
  - **vii. Pacific Ocean**
  - **viii. Atlantic Ocean**
  - **ix. Great Basin**
  - **x. Great Plains**
  - **xi. Appalachian Mountains**
  - **xii. Gulf of Mexico**
  - **xiii. Mississippi River**
  - **xiv. Great Salt Lake**
  - **xv. Atlantic Ocean**

B. Central America: Complete the following steps on the Central American Map:

- **a. Label each of the following countries:**
  - **i. Mexico**
  - **ii. Guatemala**
  - **iii. Belize**
  - **iv. El Salvador**
  - **v. Honduras**
  - **vi. Nicaragua**
  - **vii. Costa Rica**
  - **viii. Panama**
  - **ix. Cuba**
  - **x. Jamaica**
  - **xi. Bahamas**
  - **xii. Haiti**
  - **xiii. Dominican Republic**
  - **xiv. Puerto Rico**
- **b. Label the following major cities:**
  - **i. Mexico City**
  - **ii. Havana**
- **c. Label and color the following physical features:**
  - **i. Gulf of Mexico**
  - **ii. Pacific Ocean**
  - **iii. Atlantic Ocean**
  - **iv. Panama Canal**
  - **v. Baja California**
  - **vi. Yucatan Peninsula**
  - **vii. Isthmus of Panama**

C. South America: Complete the following steps on the South American Map:

- **a. Label each of the following countries:**
  - **i. Colombia**
  - **ii. Peru**
  - **iii. Venezuela**
  - **iv. Guyana**
  - **v. Suriname**
  - **vi. French Guiana**
  - **vii. Ecuador**
  - **viii. Brazil**
  - **ix. Bolivia**
  - **x. Paraguay**
  - **xi. Chile**
  - **xii. Argentina**
  - **xiii. Uruguay**
- **b. Label the following major cities:**
  - **i. Sao Paulo**
  - **ii. Bogota**
  - **iii. Lima**
  - **iv. Rio de Janeiro**
- **c. Label and color the following physical features:**
  - **i. Pacific Ocean**
  - **ii. Atlantic Ocean**
  - **iii. Andes Mountains**

iv. Cape Horn
v. Amazon River

D. Africa: Complete the following steps on the African Map:

a. Label each of the following countries:
i. Morocco
ii. Algeria
iii. Egypt
iv. Tunisia
v. Libya
vi. Western Sahara
vii. Mauritania
viii. Mali
ix. Niger
x. Chad
xi. Sudan
xii. South Sudan (not in the atlas)
xiii. Ethiopia
xiv. Eritrea
xv. Djibouti
xvi. Somalia
xvii. Senegal
xviii. Gambia
xix. Guinea-Bissau
xx. Guinea
xxi. Sierra Leone
xxii. Liberia
xxiii. Cote D'Ivoire
xxiv. Burkina Faso
xxv. Ghana
xxvi. Togo
xxvii. Benin
xxviii. Nigeria
xxix. Cameroon
xxx. Central African Republic
xxxi. Equatorial Guinea
xxxii. Sao Tome & Principe
xxxiii. Gabon
xxxiv. Congo
xxxv. Democratic Republic of the Congo
xxxvi. Uganda
xxxvii. Kenya
xxxviii. Rwanda
xxxix. Burundi
xl. Tanzania
xli. Angola
xlii. Zambia
xliii. Malawi
xliv. Mozambique
xlv. Madagascar
xlvi. Namibia
xlvii. Botswana
xlviii. Zimbabwe
xlix. Swaziland
l. Lesotho
li. South Africa

b. Label the following major cities:
i. Cairo
ii. Lagos
iii. Johannesburg
iv. Kinshasa
v. Khartoum

c. Label and color the following physical features:
i. Nile River
ii. Congo River
iii. Lake Victoria
iv. Lake Chad
v. Indian Ocean
vi. Atlantic Ocean
vii. Mediterranean Sea
viii. Red Sea
ix. Sahara Desert
x. Strait of Gibraltar
xi. Cape of Good Hope
xii. Suez Canal

E. Middle East: Complete the following steps on the Middle East Map:

a. Label each of the following countries:
i. Afghanistan
ii. Egypt
iii. Turkey
iv. Cyprus
v. Lebanon
vi. Israel
vii. Jordan
viii. Iraq
ix. Saudi Arabia
x. Iran
xi. Kuwait
xii. Bahrain
xiii. Qatar
xiv. United Arab Emirates
xv. Oman
xvi. Yemen
xvii. Syria

b. Label the following major cities:
i. Mecca (Makkah)
ii. Medina
iii. Cairo
iv. Tehran

c. Label and color the following physical features:
i. Arabian Peninsula
ii. Sinai Peninsula
iii. Mediterranean Sea
iv. Caspian Sea
v. Red Sea
vi. Arabian Sea
vii. Dead Sea
viii. Persian Gulf
ix. Strait of Hormuz
x. Nile River
xi. Tigris River
xii. Euphrates River

F. South Asia: Complete the following steps on the South Asia Map:

a. Label each of the following countries:
i. Afghanistan
ii. Pakistan
iii. India

iv. Sri Lanka
v. Maldives
vi. Nepal
vii. Bhutan
viii. Bangladesh

b. Label the following major cities:
i. Calcutta
ii. Mumbai
iii. New Delhi
iv. Karachi

c. Label and color the following physical features:
i. Arabian Sea
ii. Bay of Bengal
iii. Ganges River
iv. Indus River
v. Himalaya Mountains
vi. Mt. Everest
vii. K2

G. Southeast Asia: Complete the following on the Southeast Asian Map:

a. Label each of the following countries:
i. Vietnam
ii. Laos
iii. Cambodia
iv. Myanmar
v. Thailand
vi. Malaysia
vii. Indonesia
viii. Philippines
ix. Brunei
x. Singapore
xi. East Timor

b. Label the following major cities:
i. Jakarta
ii. Manila
iii. Bangkok
iv. Yangon

c. Label and color the following physical features:
i. Mekong River
ii. Indian Ocean
iii. Pacific Ocean
iv. Bay of Bengal
v. Gulf of Tonkin

H. East Asia: Complete the following on the East Asia Map:

a. Label each of the following countries:
i. China
ii. Japan
iii. Mongolia
iv. North Korea
v. South Korea
vi. Taiwan

b. Label the following major cities:
i. Tokyo
ii. Beijing
iii. Shanghai
iv. Hong Kong
v. Taipei
vi. Seoul

c. Label and color the following physical features:
i. Himalaya Mountains
ii. Mount Fuji
iii. Gobi Desert
iv. Yellow River
v. Yangtze River
vi. Xi River
vii. Yellow Sea
viii. Pacific Ocean
ix.

I. Russia and the Former Soviet Republics: Complete the following on the Russia Map:

a. Label each of the following countries:
i. Russia
ii. Belarus
iii. Ukraine
iv. Moldova
v. Georgia
vi. Armenia
vii. Turkmenistan
viii. Azerbaijan
ix. Tajikistan
x. Kyrgyzstan
xi. Kazakhstan
xii. Uzbekistan
xiii. Estonia
xiv. Latvia
xv. Lithuania

b. Label the following major cities:
i. Moscow
ii. St. Petersburg
iii. Kiev

c. Label and color the following physical features:
i. Arctic Ocean
ii. Lake Baikal
iii. Caspian Sea
iv. Aral Sea
v. Black Sea
vi. Barents Sea
vii. Baltic Sea
viii. Bering Sea
ix. Ural Mountains

J. Europe: Complete the following on the Europe Map:

a. Label each of the following countries:
i. Albania
ii. Andorra
iii. Austria
iv. Belarus
v. Belgium
vi. Bosnia and Herzegovina
vii. Bulgaria
viii. Croatia
ix. Czech Republic
x. Denmark
xi. Estonia
xii. Finland
xiii. France
xiv. Germany
xv. Greece

xvi. Hungary
xvii. Iceland
xviii. Ireland
xix. Italy
xx. Latvia
xxi. Liechtenstein
xxii. Lithuania
xxiii. Luxembourg
xxiv. Macedonia
xxv. Malta
xxvi. Moldova
xxvii. Monaco
xxviii. Montenegro
xxix. Netherlands
xxx. Norway
xxxi. Poland
xxxii. Portugal
xxxiii. Romania
xxxiv. Russia
xxxv. San Marino
xxxvi. Serbia
xxxvii. Slovakia
xxxviii. Slovenia
xxxix. Spain
xl. Sweden
xli. Switzerland
xlii. Turkey
xliii. Ukraine
xliv. United Kingdom
xlv. Vatican City (Holy See)

b. Label the following major cities:

i. London
ii. Paris
iii. Madrid
iv. Berlin
v. Athens
vi. Rome

c. Label and color the following physical features:

i. Atlantic Ocean
ii. Baltic Sea
iii. North Sea
iv. Mediterranean Sea
v. Adriatic Sea
vi. Aegean Sea
vii. English Channel
viii. Strait of Gibraltar
ix. Black Sea
x. Thames River
xi. Rhine River
xii. European Alps
xiii. Pyrenees Mountains
xiv. Iberian Peninsula
xv. Scandinavia Peninsula

Map Labeling Instructions

All writing should be straight and horizontal
Use arrows to show small locations or features – don't try to cram the name into a small space!
Color the feature as directed and write the name in black.

Map Feature	Symbol and Color
Country	Label
Rivers	Red line that follows the river's course
Mountain Peaks / Individual Mountains	Brown triangle inside a brown circle
Mountain Ranges or Hills	Line of brown triangles
Deserts	Yellow circle covering the feature
Plateaus	Green circle covering the feature
Plains	Purple circle covering the feature
Peninsulas	Orange circle covering the feature
Bodies of Water (lakes, waterfalls, oceans, channels, gulfs, canals, straits, bays, seas)	Outline the edges only in blue
Any Other Features	Not Described Above Label in black

Unit 1 Terms – AP Human Geography

Sequent occupance:

Cultural landscape:

Arithmetic density:

Physiological density:

Hearth:

Diffusion:

Relocation diffusion:

Expansion diffusion:

-Hierarchical diffusion:

-Contagious diffusion:

-Stimulus diffusion:

Absolute distance:

Relative distance:

Distribution:

Environmental determinism:

Absolute location:

Relative location:

Site:

Situation:

Space Time Compression:

Friction of Distance:

Distance Decay:

Networks:

Connectivity:

Accessibility:

Space:

Spatial Distribution:

Size:

Scale:

Formal Region:

Functional Region:

Vernacular Region:

Possibilism:

Natural Landscape:

Pattern:

Toponym:

The World

Continents: Africa, Antarctica, Asia, Australia, Europe, North America and South America



Africa

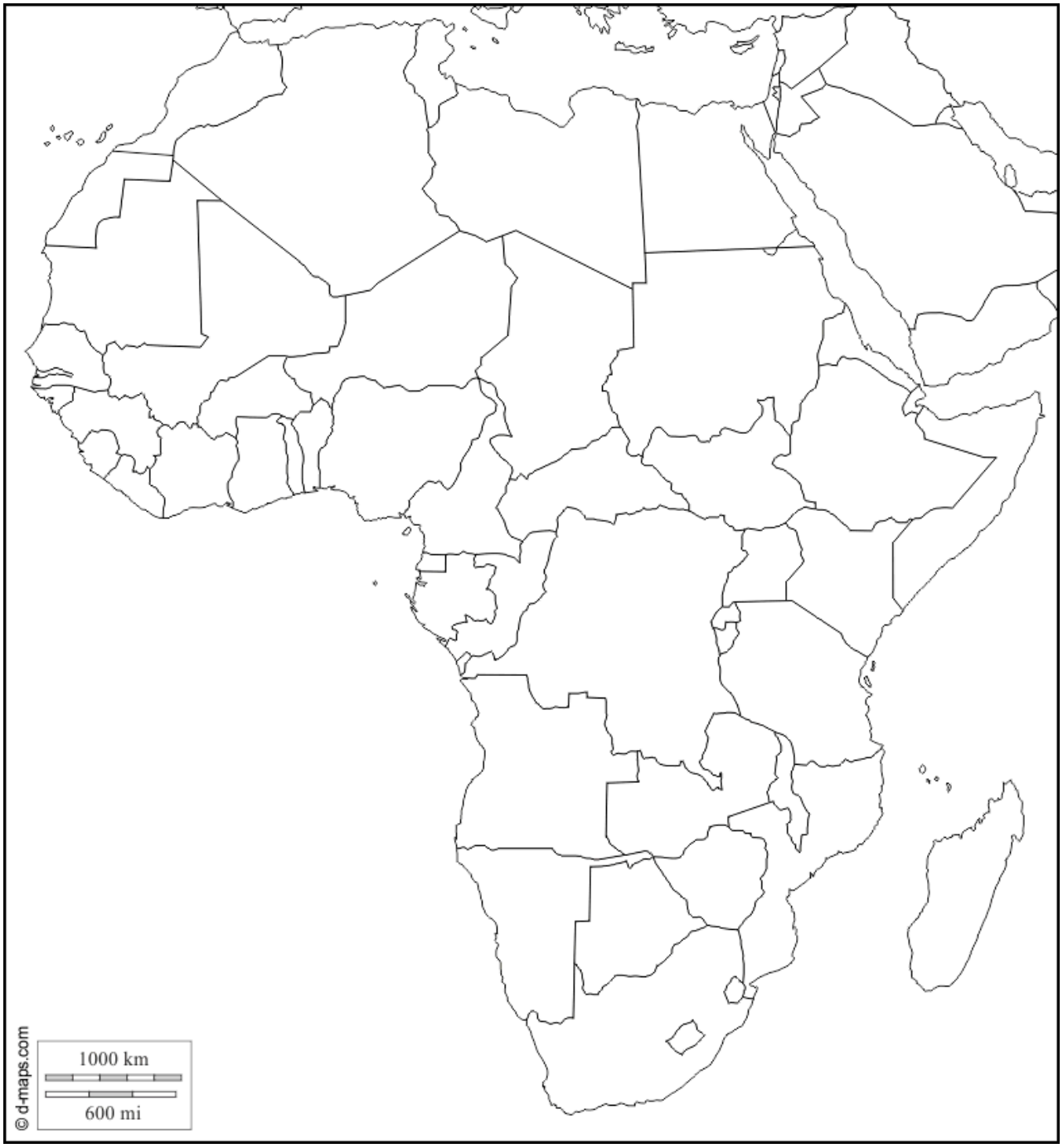

Algeria, Angola, Benin, Botswana, Burkina, Burundi, Cameroon, Cape Verde*, Central African Republic, Chad, Comoros, Congo, Democratic Republic of Congo, Djibouti, Egypt, Equatorial, Guinea, Eritrea, Ethiopia, Gabon, Gambia, Ghana, Guinea, Guinea-Bissau, Ivory Coast, Kenya Lesotho, Liberia, Libya, Madagascar, Malawi, Mali, Mauritania, Mauritius*, Morocco, Mozambique, Namibia, Niger, Nigeria, Rwanda, Sao Tome and Principe, Senegal, Seychelles*, Sierra Leone, Somalia, South Africa, South Sudan, Sudan, Swaziland, Tanzania, Togo, Tunisia, Uganda, Western Sahara, Zambia, Zimbabwe

United States



Alabama, Alaska, Arizona, Arkansas, California, Colorado, Connecticut, Delaware, District of Columbia, Florida, Georgia, Hawaii, Idaho, Illinois, Indiana, Iowa, Kansas, Kentucky, Louisiana, Maine, Maryland, Massachusetts, Michigan, Minnesota, Mississippi, Missouri, Montana, Nebraska, Nevada, New Hampshire, New Jersey, New Mexico, New York, North Carolina, North Dakota, Ohio, Oklahoma, Oregon, Pennsylvania, Rhode Island, South Carolina, South Dakota, Tennessee, Texas, Utah, Vermont, Virginia, Washington, West Virginia, Wisconsin, Wyoming

Canada



Ontario, Quebec, British Columbia, Alberta, Manitoba, Saskatchewan, Nova Scotia, New Brunswick, Newfoundland and Labrador, Prince Edward Island, Northwest Territories, Yukon, Nunavut

Latin America



Mexico
Caribbean: Cuba, Dominican Republic, Haiti, Jamaica
Central America: Belize, Costa Rica, El Salvador, Guatemala, Honduras, Nicaragua, Panama
South America: Argentina, Bolivia Brazil, Chile, Colombia, Ecuador, Guyana, Paraguay, Peru, Suriname, Uruguay, Venezuela

Southwest Asia and Central Asia

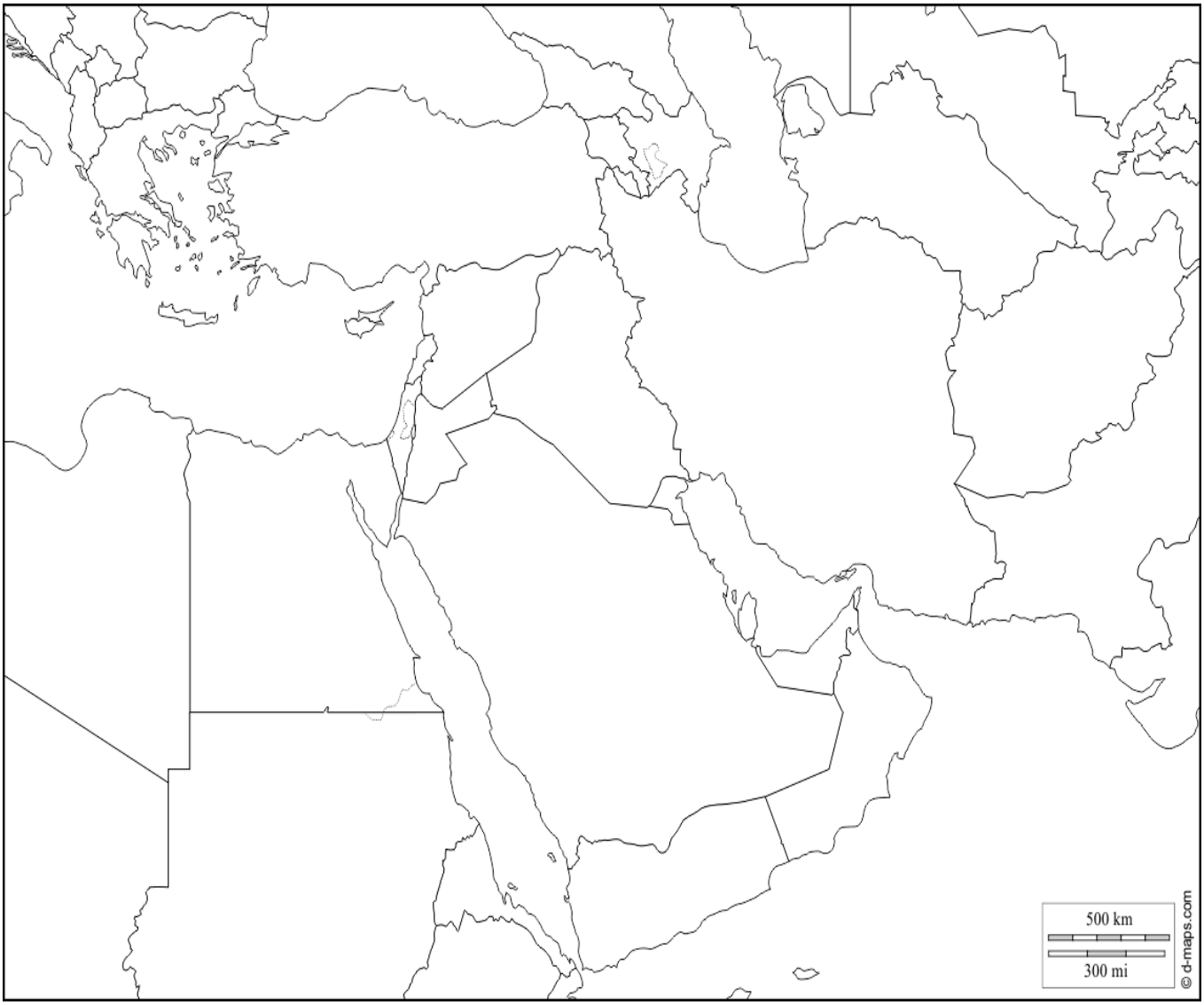

Southwest Asia: Bahrain, Iraq, Iran, Israel, Jordan, Kuwait, Lebanon, Oman, Palestine, Qatar, Saudi Arabia, Syria, Turkey, United Arab Emirates, Yemen
Central Asia: Afghanistan, Armenia, Azerbaijan, Georgia, Turkmenistan, Uzbekistan

CENTRAL ASIA, SOUTH ASIA, EAST ASIA and SOUTHEAST ASIA

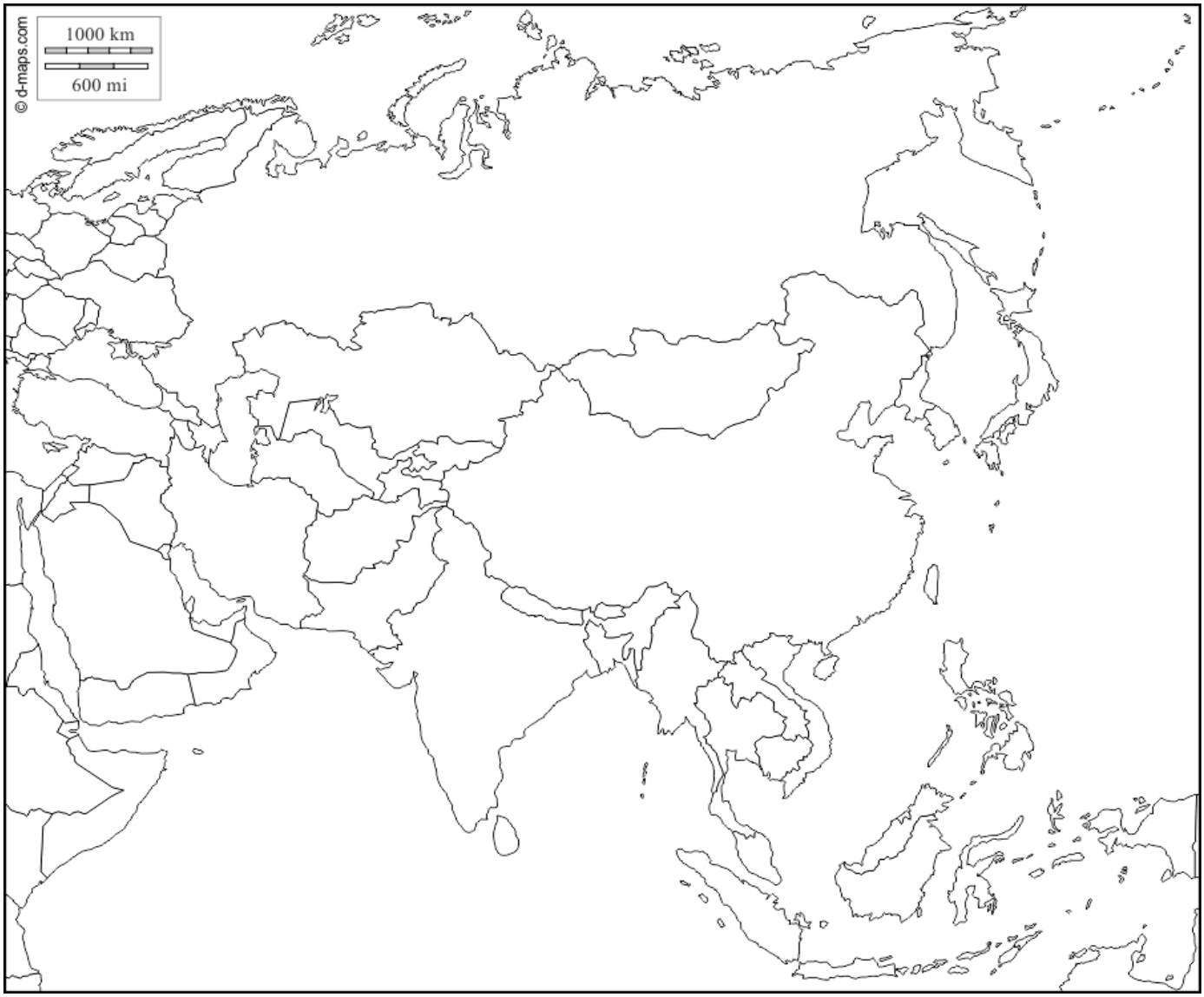

Central Asia: Afghanistan, Kazakhstan, Kyrgyzstan, Tajikistan, Turkmenistan, Uzbekistan
South Asia: Bangladesh, Bhutan, India, Maldives, Nepal, Pakistan, Sri Lanka
East Asia: China, Japan, Mongolia, North Korea, South Korea, Taiwan
Southeast Asia: Brunei, Cambodia, East Timor, Indonesia, Laos, Malaysia, Myanmar, Philippines, Singapore, Thailand, Vietnam

EUROPE



Albania, Andorra, Austria, Belarus, Belgium, Bosnia and Herzegovina, Bulgaria, Croatia, Cyprus, Czech Republic, Denmark, Estonia, Finland, France, Germany, Greece, Hungary, Iceland, Ireland, Italy, Latvia, Liechtenstein, Lithuania, Luxembourg, Macedonia, Malta, Moldova, Monaco, Montenegro, Netherlands, Norway, Poland, Portugal, Romania, San Marino, Serbia, Slovakia, Slovenia, Spain, Sweden, Switzerland, Turkey, Ukraine, United Kingdom, Vatican City

OCEANIA



Australia, Papua New Guinea, Solomon Islands, Vanuatu, New Caledonia, New Zealand, Fiji

CITIES

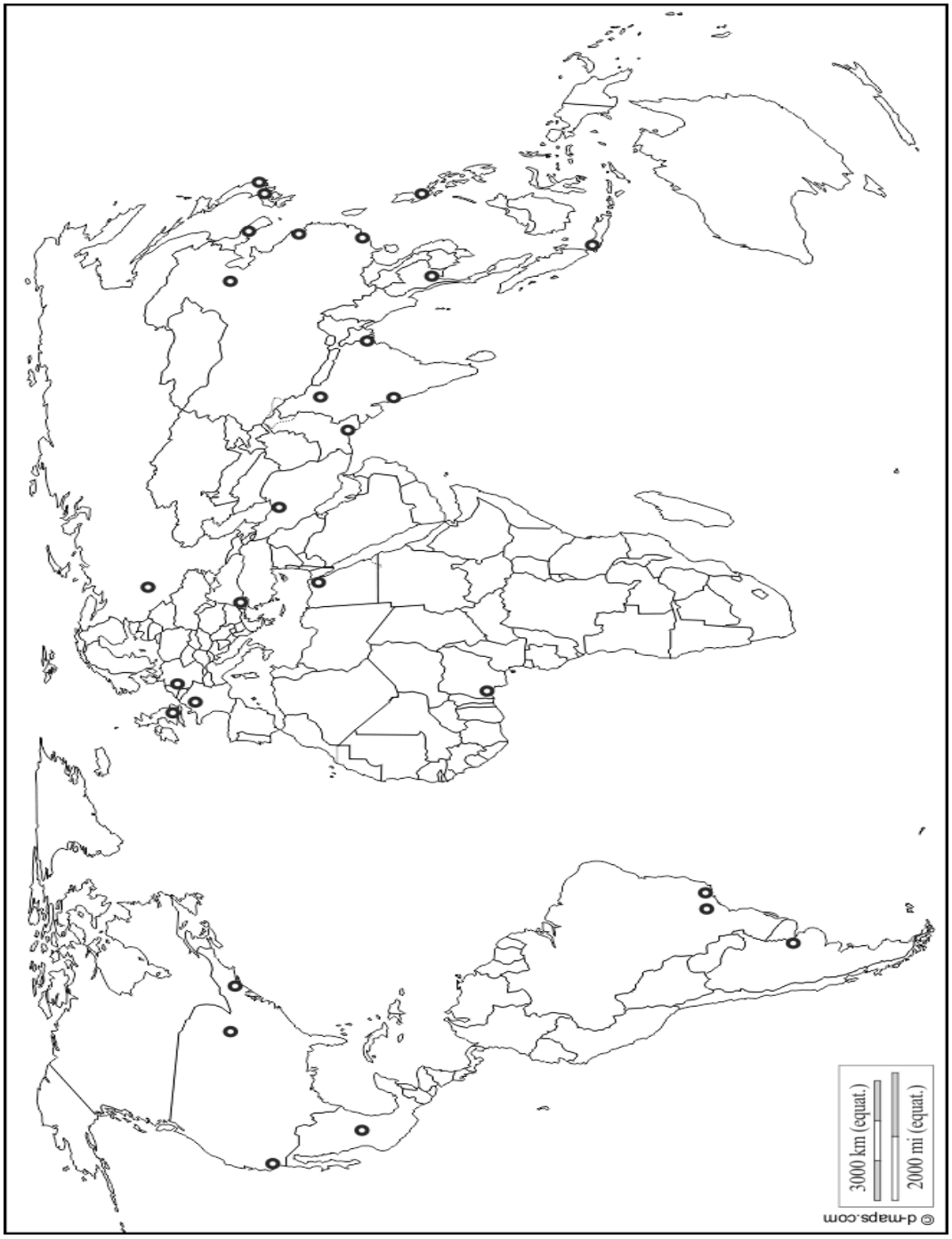

Bangkok, Beijing, Buenos Aires, Cairo, Chicago, Dhaka, Essen, Hong Kong, Istanbul, Jakarta, Karachi, Lagos, London, Los Angeles, Manila, Mexico City, Moscow, Mumbai, New Delhi, New York City, Osaka, Paris, Rio de Janeiro, Sao Paulo, Seoul, Shanghai, Tehran, Tokyo

PHYSICAL FEATURES



Bodies of Water: Atlantic Ocean, Caribbean Sea, Gulf of Mexico, Hudson Bay, Pacific Ocean
Lakes and Rivers: Amazon, Colorado, The Great Lakes (Erie, Huron, Michigan, Ontario, Superior) Mississippi, Missouri, Ohio

Bodies of Water: Aral Sea, Arctic Ocean, Atlantic Ocean, Baltic Sea, Bay of Bengal, Black Sea, Caspian Sea, China Seas (Yellow, East, South), Indian Ocean, Mediterranean Sea, North Sea, Pacific Ocean, Persian Gulf, Red Sea
Lakes and Rivers: Brahmaputra, Congo, Danube, Euphrates, Ganges, Mekong, Niger, Nile, Tigris, Volga, Yangtze, Yellow, Zambezi

PHYSICAL FEATURES

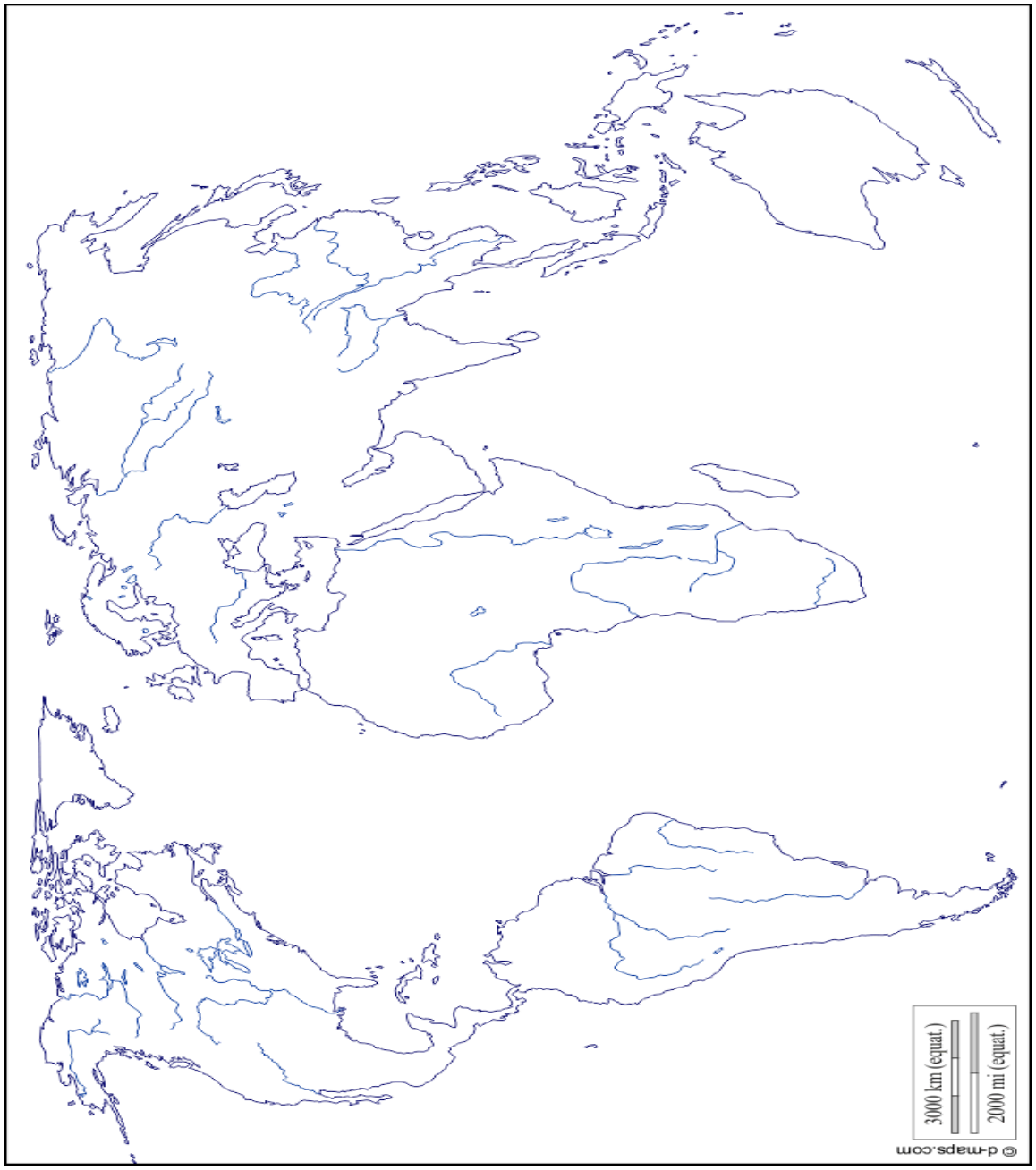

PHYSICAL FEATURESMountains: Andes, Appalachian, Rocky, Alps, Atlas, Himalaya, Hindu, Kush, Ural