UNDERSTANDING THE TEXT

Draw an illustration of what Anna and Jack might do after they finish playing games



CHARACTERS CHANGE

Tell about Anna and Jack's attitude at the beginning of the passage and at the end of the passage to show how he changed. Write or draw faces in the boxes.

Beginning	End

Can't remember? Reread the story.

Name _____ Date _____



Let's Go Surfin'



Double Digit Addition

Add the numbers together. Write the sum.

80 + 10 =	20 + 30 =
40 + 60 =	50 + 10 =
30 + 40 =	10 + 70 =
60 + 20 =	70 + 20 =

©TK Kreations

Name:_____

IN AND OUT BOXES

Directions: Solve each problem.



1.

- 10	
58	
35	
47	
98	

2.

- 10	
85	
76	
25	
19	

3.

- 10	
45	
61	
36	
58	

4.

- 10	
78	
65	
13	
22	

5.

- 10	
35	
87	
39	
40	

6.

- 10	
52	
68	
93	
84	

Created by Teaching Second Grade

Name:_____

MATH
1.NBT.C4

Add.

22 + 5 27	18 + 10
Write a matching SUBTRACTION problem. 27-22=5	Write a matching SUBTRACTION problem.

22 + 4	18 + 10
Write a matching SUBTRACTION problem.	Write a matching SUBTRACTION problem.

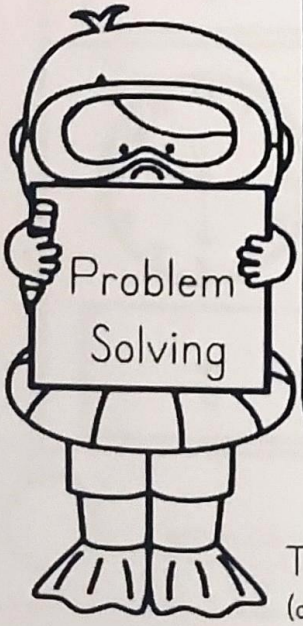

This was:: **EASY** **JUST RIGHT** **HARD**
(circle one)

Copyright © 2020 Teacher's Brain. All Rights Reserved

Name _____ Date _____

Splash Pad



Time to the hour and half hour

Write the correct digital time under the analog clock.

 :	 :	 :	 :
 :	 :	 :	 :
 :	 :	 :	 :

©TK Kreations

You'll need a dice (die). What Read a story do you remember?

roll & retell



What is the story mostly about?



Who are the main characters?



Where does the story take place?



When does the story take place?



What happened at the beginning, middle, and end of the story?



What questions do you have about the story?

www.fun-n-f...blogspot.co...

Camping Trip

graphing



Directions:

Count the foods, tally and graph. Answer the questions on the graph.

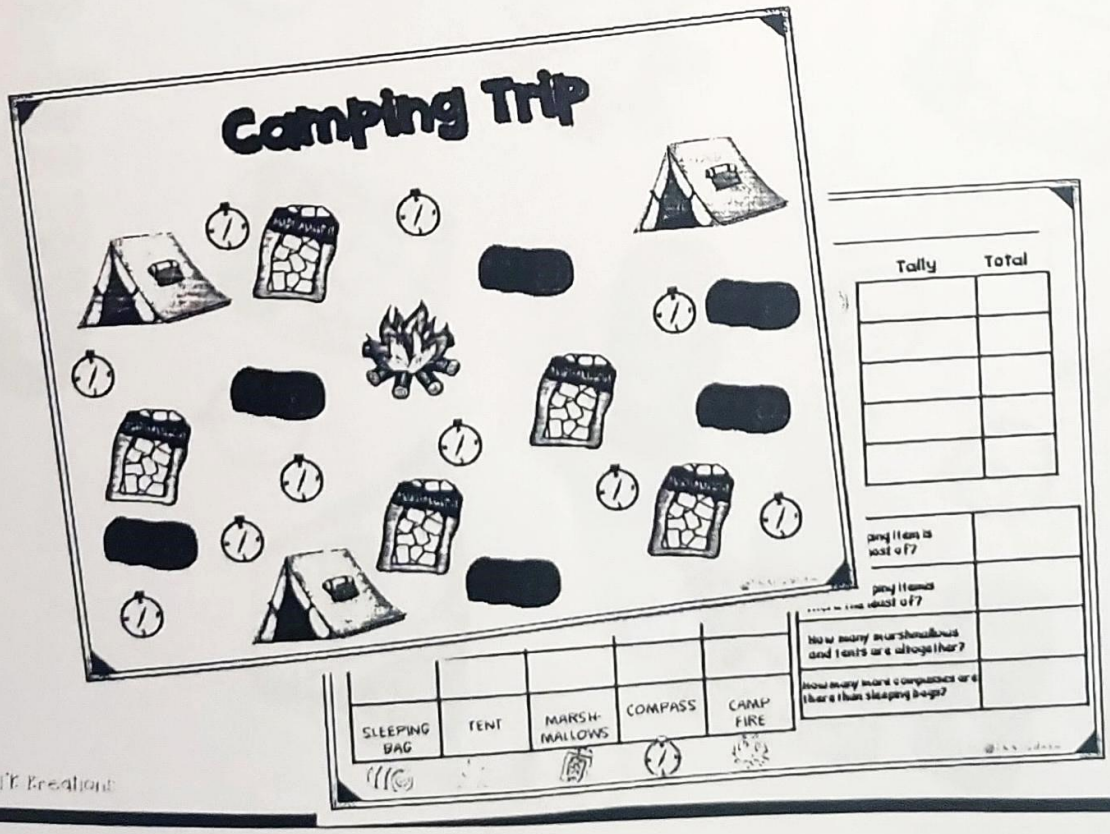

©TK Creations

Camping Trip









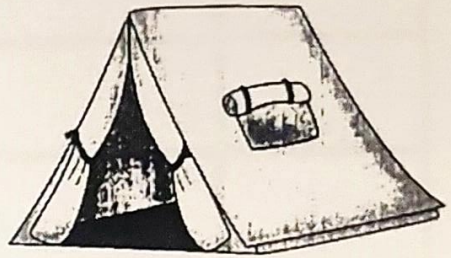































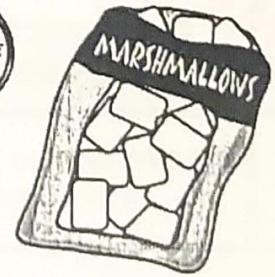



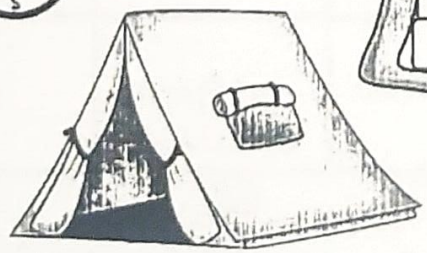





©TK Kreations

Camping Trip

Name:_____

SLEEPING BAG	TENT	MARSH-MALLOWS	COMPASS	CAMP FIRE













	Tally	Total

Which camping item is there the most of?	
Which camping itemis there the least of?	
How many marshmallows and tents are altogether?	
How many more compasses are there than sleeping bags?	

©TK Kreations

Name: _____

PLACE VALUE



5 in hundreds place = green
6 in the tens place = blue
7 in the ones place = yellow
8 in the hundreds place = red

Created by Teaching Second Grade