Summer Learning Packet

Students entering 5th Grade

Purpose

The purpose of summer learning packets is to provide families with some guidance and structure for academic work over the summer months. Working on academic tasks over the summer will help students practice and reinforce essential skills, working to lessen the "summer slide" – or regression in skills – that is often seen when students disengage from all academic work for an extended period of time.

Student Requirements

Students entering 5th grade are assigned the attached packet of worksheets. Show all your work. Summer learning packets will be collected during the first week of school in the fall.

Have a safe and relaxing summer!

- Mrs. del Rio

Name_____

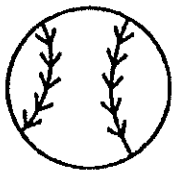

Baseball in the United States

Baseball is known as America's pasttime and has a long history in the United States. It is said tha twhat we now know as baseball began before the Civil War and was first known as "rounders". Over time, elements from the English game of cricket were added and rules about scoring and record keeping made the game what it is today.

The first professional baseball league was formed in 1871. By the end of the 20th century, most big cities in the eastern United States had their own professional team. These teams were divided into the National League and the American League. The teams in each league would play each other during the regular season, trying to win the pennant. The winner of the pennant from each league would face each other in the World Series at the end of the season.

By the 1920s, baseball was very popular in America, with players like Babe Ruth gaining many fans. In the 1950s, baseball began to expand to western cities. Some eastern teams moved west and new teams were formed.

Today, there are thirty major league teams with both the American and National Leagues split into three division: east, central, and west. Today, teams still play against teams from their own divisions during the regular season, but they also have opportunities to play teams from the opposite league as well. At the end of each season, the first place teams from the American and National Leagues still battle each other in the World Series.

Baseball has evolved over the years, but it will always be known as our national pasttime.

Read this informational text. Use it to answer the questions on the "Baseball in the United States Comprehension Check In".

© Kendra's Kindergarten 2018

Name_____



Baseball in the United States Comprehension Check In

What is the main idea of this text?

_____

What English game was baseball inspired by?

_____

In what part of the United States were the first professional baseball teams formed?

_____

How is the World Champion determined each year?

_____

_____

© Kendra's Kindergarten 2018

How is baseball in the United States today different from baseball in the past? How is it the same?

_____

_____

_____

_____

_____

_____

_____

Read the "Baseball in the United States" text. Use the information in the text to answer the questions. Underline the evidence you use in the text.

Name_____



No Fragments! No Run-Ons!

Because of the rain. (fragment, run-on)

Yesterday I went to the beach and we saw a huge whale it was jumping out of the water and making huge splashes my sister was so happy she loves whales. (fragment, run-on)

So I went to the pool instead. (fragment, run-on)

I'm so glad school is out don't get me wrong I love my school but sometimes you just need a break to go swimming and eat ice cream and play with your friends. (fragment, run-on)

And of course, ice cream. (fragment, run-on)

© Kendra's Kindergarten 2018

Determine if each sentence is a fragment or a run-on (circle your choice). Rewrite the sentence / sentences to form complete sentences.

Name_____

© Kendra's Kindergarten 2017

Narrative Writing



Write a true story about something that happened during your summer vacation. Include details about the who was there and where you were. Use quotation marks and dialogue. Make sure your story includes a beginning, middle, and ending.

Name_____

© Kendra's Kindergarten 2018

Opinion Writing



What is one change you would like to see at your school next year? Begin with a topic sentence that introduces the change. Give at least three reasons the change should be made. Include facts and details to support your reasons. Finish with a strong concluding sentence.

Name_____

Proofreading Practice



When summertime comes around maney people in the united states enjoy traveling In fact, 77% of americans plan on taking a trip this summer and 80% of these will travel within the Country. The top three destinations in the united states are las vegas, new york, and orlando? many americans will also visit beaches, with miami, myrtle beach, honolulu san diego, and fort lauderdale being the most popular Traveling in the united states is a big business, with americans spendin a average of $1,180 per person each summer. Some of this tourists will fly, while others will travel by car There are several factors too consider when deciding between these to options, and cost iz often the most important. A large group may decide two save money by driving, while smaller groups may like to save they're time by flying. Whereever you're travels take you this summer, stay safe and hav fun!

Proofread this passage, correcting the mistakes you find.

© Kendra's Kindergarten 2018

Name_____

Which Word?



two	to	too	their	there	they're

I cannot wait for my trip _____ the lake! My whole family will be going _____ the cabin for _____ entire weeks! Our friends, the Smiths, are going _____ meet us _____. We always have the best time with them because _____ so funny. They have five kids in their family - three girls and _____ boys! That's a lot of kids! _____ even going to bring _____ dog, Milo. He is _____ years old an knows lots of tricks. My mom says we are _____ busy to have a dog, so it will be nice to spend some time with Milo. The lake is my favorite place in the world! As soon as we get _____ I'm going _____ put on my suit and jump in the water! I hope my sisters put on _____ suits and join me! They think the water can be _____ cold, but for me, it's just right. I also would like _____ go for a ride in the boat and try _____ catch a fish. My dad says _____ are lots of bass in the lake. I also can't wait _____ make s'mores. I like to stack _____ marshmallows between my graham crackers and chocolate My mom says that makes the s'more _____sticky, but I say it's delicious! _____ are so many fun things _____ do at the lake! I can't wait _____ get _____ and enjoy my favorite part of summer!

Use the words from the box to complete the story. You con use the words more than once.

© Kendra's Kindergarten 2017

Name_____

© Kendra's Kindergarten 2017



Summer Book Log

Fiction Books	Nonfiction Books

Write the names of the books you read this summer. Make sure to record fiction and nonfiction books in the correct columns.

Name_____

2 by 1 Multiplication



93 x 3	48 x 9	74 x 7	46 x 5
52 x 3	34 x 2	37 x 8	62 x 7
11 x 5	29 x 7	88 x 6	67 x 5
60 x 6	35 x 3	49 x 7	73 x 2

Solve the multiplication problems.

© Kendra's Kindergarten 2018

Name_____

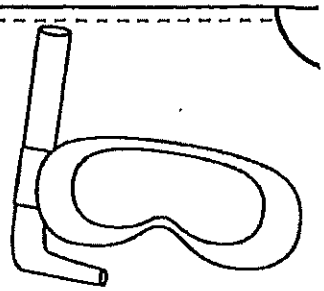

2 by 2 Multiplication

63 x 65	45 x 14	54 x 29	48 x 76
92 x 11	38 x 39	87 x 24	62 x 84
51 x 45	28 x 77	80 x 50	37 x 85
10 x 22	39 x 43	99 x 53	76 x 78

Solve the multiplication problems.

© Kendra's Kindergarten 2018

Name _____



3 by 1 Multiplication

598 x 4 =	492 x 6 =	148 x 3 =	284 x 7 =
882 x 1 =	729 x 2 =	293 x 2 =	192 x 9 =
920 x 6 =	204 x 7 =	812 x 4 =	330 x 8 =
721 x 5 =	432 x 3 =	561 x 1 =	629 x 2 =

Solve the multiplication problems.

© Kendra's Kindergarten 2018

Name _____



4 by 1 Multiplication

2863 x 6 =	4574 x 2 =	1965 x 4 =	5693 x 3 =
6743 x 1 =	3896 x 9 =	8742 x 2 =	2662 x 8 =
5841 x 4 =	1370 x 7 =	2680 x 5 =	8951 x 5 =
2150 x 5 =	1697 x 3 =	7883 x 1 =	5629 x 5 =

Solve the multiplication problems.

© Kendra's Kindergarten 2018

Name _____

Finding Area & Perimeter

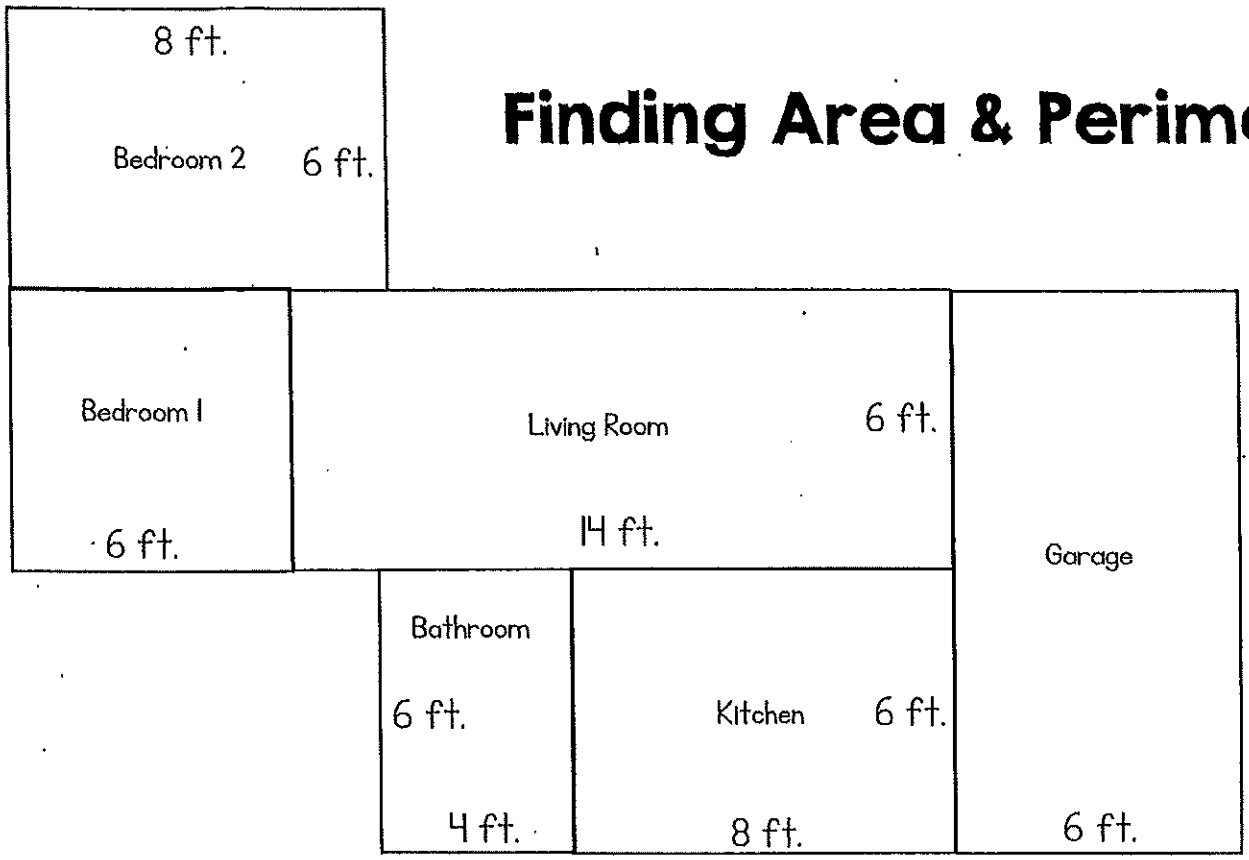

What is the area of the garage? _____

What is the perimeter of the living room? _____

What is the area of the two bedrooms combined? _____

What is the perimeter of the entire house? _____

What is the area of the entire house? _____

Use the diagram to answer the questions.

© Kendra's Kindergarten 2018

Name_____



Geometry: Draw It!

lines	right angle	points
acute angle	perpendicular lines	ray
line segments	obtuse angle	parallel lines

Draw a picture to represent each object.

© Kendra's Kindergarten 2017

Name_____



Long Division Practice

$6\overline{)205}$ $4\overline{)429}$ $8\overline{)309}$

$9\overline{)536}$ $2\overline{)974}$ $3\overline{)752}$

$3\overline{)419}$ $6\overline{)540}$ $8\overline{)630}$

$3\overline{)189}$ $7\overline{)765}$ $4\overline{)322}$

Solve the division problems.

© Kendra's Kindergarten 2018

Name_____



Long Division Practice (2)

$1\overline{)2455}$ $4\overline{)4899}$ $3\overline{)3569}$

$9\overline{)5226}$ $2\overline{)9024}$ $4\overline{)7322}$

$6\overline{)4909}$ $2\overline{)5290}$ $7\overline{)6390}$

$5\overline{)1249}$ $7\overline{)7105}$ $8\overline{)4892}$

Solve the division problems.

© Kendra's Kindergarten 2018