NTI Choice Board

Kindergarten

Please complete and initial one activity per NTI day, per subject, a



Literacy



Draw a picture of this sentence: The red cap is on the	Read two different bo Then, compare the main characters. How are alike? How are they different? (An adult can do the writing.)	Write a list of 6 nouns you can see in your home. 	Create a sentence w the following sight wo here on put
Make a list of 5 words that rhyme with: pig	Read a book for 20 minutes. 	Practice your sight w	Read a nonfiction bo and write down 3 fac you learned.
Find a nonfiction and a fiction text in your ho Explain to someone the difference between the two. 	Think of your favorite fairy tale or story. Re it to someone in your home.	Read a story then dra picture of the main character and the se	Write all the letters i the alphabet. Choos letters and draw a picture that begins w those letters. 
Find a stuffed anima get cozy. Read to it for 20 minutes.	Look at the word: train Take away one letter make a new word.	Practice your sight w	Describe two things you think are cozy

Activities are only required when the district is learning instructio

NTI Choice Board

Kindergarten

Please complete and initial one activity per NTI day, per subject, and return to binder.



Math



Draw a picture to solve: Sam has 5 red ornaments and 4 green ornaments. How many ornaments does Sam have?	Count by 10s to 100.	List three things in your house that has numbers on it. (An adult can do the writing)	Draw a picture of 3 objects shaped like a square you find in your home.
Practice naming coins. 	Is this true or false? Draw a picture to prove your answer. 5 + 6 = 4 + 9	Solve this story problem: Nan has 8 cookies. She gives 3 to Ted. How many cookies does she have now?	Start at the number 6 and count to 100 to someone at your hom
Find two objects in your kitchen. Compare the weight. Draw a picture of the heaviest object.	Find 3 circles in your home. Draw a picture of each thing you find. 	Draw a picture to solve: 10 + ? = 16	Find 3 different objec your house and put t in order from shortes tallest. 
Count how many win and doors are in your home. Compare the two numbers. Circle the greater number.	Draw a picture and s 7 + 2 = ?	Count to 100 to somec in your house.	Line up the people in home from tallest to shortest. Make a lis

Activities are only required when the district is learning instructio