Fact of the Day

3 x 7 = 21

Equal Groups

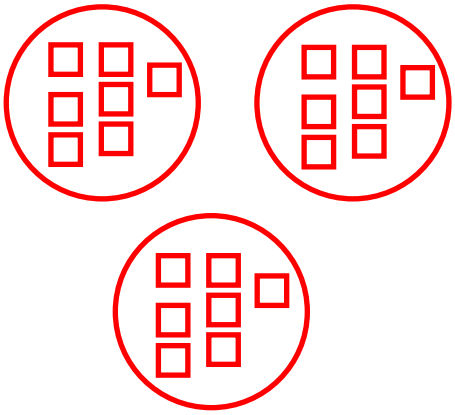

Array



Area Model

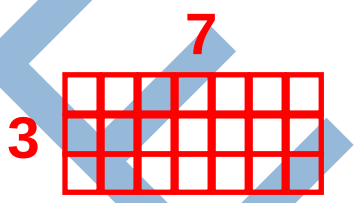

Repeated Addition

7 + 7 + 7 = 21

Related Division Fact(s)

21 ÷ 3 = 7
21 ÷ 7 = 3

Number Line

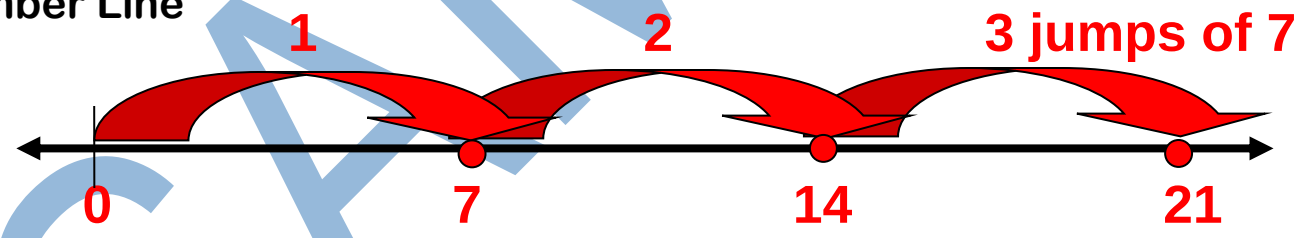

Word Problem

baskets		apples
Unit		Unit

Connie has 3 baskets.

Each basket has 7 apples.

How many apples does Connie have?

SAMPLE

Fact of the Day

_____x_____=_____

Equal Groups	Array	Area Model

Repeated Addition	Related Division Fact(s)

Number Line



Word Problem

Unit	Unit