NAME _____ DATE _____ PERIOD _____

Lesson 4 Extra Practice

Volume of Prisms

Find the volume of each prism. Round to the nearest tenth if necessary.

1.

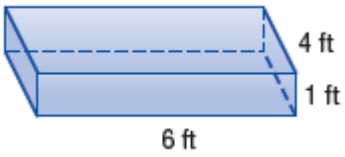

2.

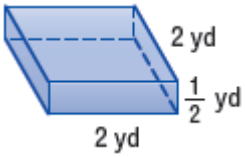

3.

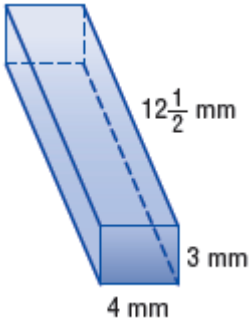

4.



5.

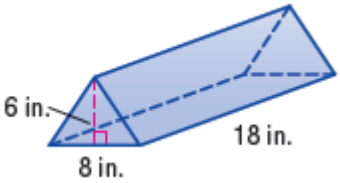

6.

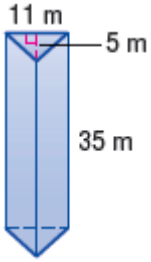

7.

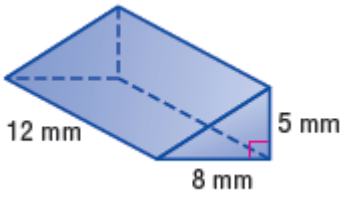

8.

